LEYENDO ESCALAS 2G

Utiliza tu conocimiento del sistema numérico para leer estas escalas que suben de a uno y de cinco en cinco.

1) ¿Cuántos ml hay? ____

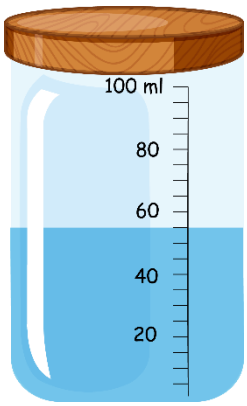

2) ¿Cuántos ml hay? ____

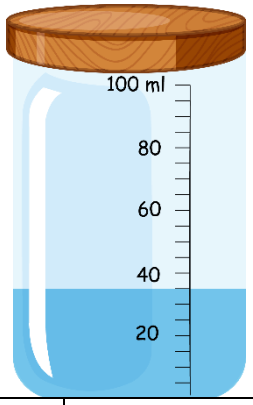

3) ¿Cuántos ml hay? ____

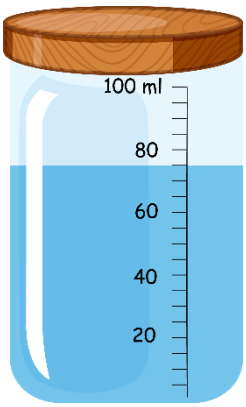

4) ¿Cuánto mide la línea? _____ mm

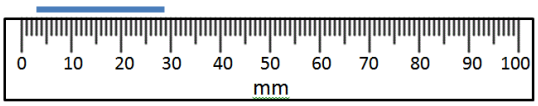

5) ¿Cuánto mide la línea? _____ mm

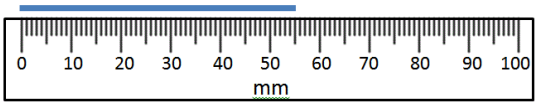

6) ¿Cuánto mide la línea? _____ mm

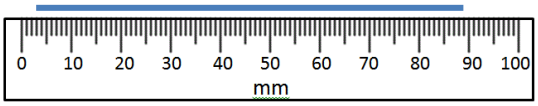

7) ¿Cuánto mide la línea? _____ mm

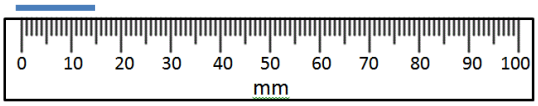

8) ¿Cuántos g hay? ____

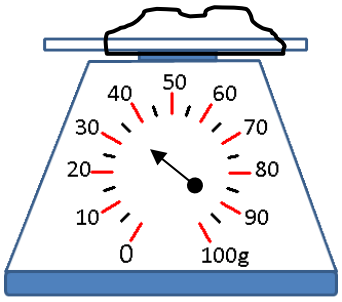

9) ¿Cuántos g hay? ____

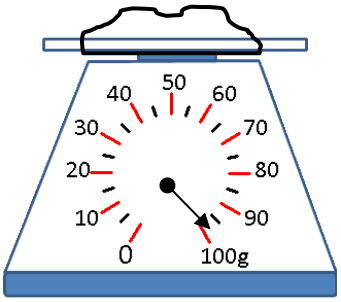

10) ¿Cuántos g hay? ____

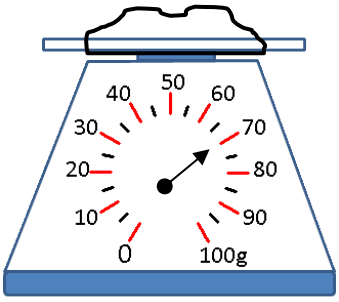

MathCenter
Free Math for Everyone

Visit us at www.math-center.org

Copyright © MathCenter 2020

LEYENDO ESCALAS 2G - RESPUESTAS

1) ¿Cuántos ml hay? 55

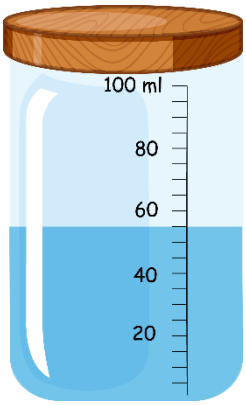

2) ¿Cuántos ml hay? 35

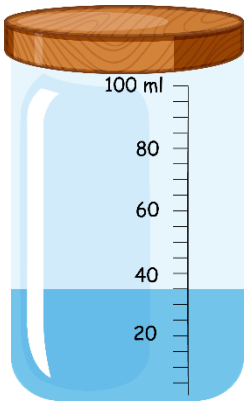

3) ¿Cuántos ml hay? 75

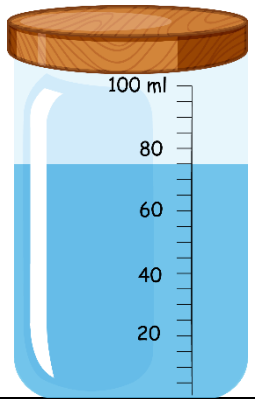

4) ¿Cuánto mide la línea? 25 mm

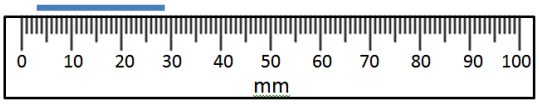

5) ¿Cuánto mide la línea? 55 mm

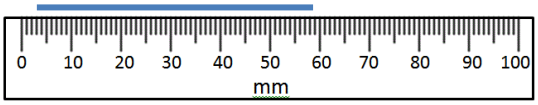

6) ¿Cuánto mide la línea? 85 mm

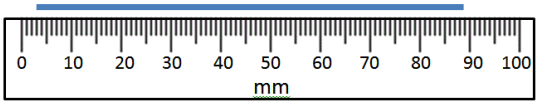

7) ¿Cuánto mide la línea? 15 mm

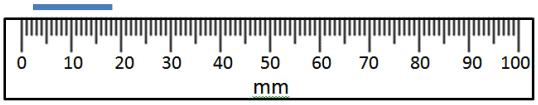

8) ¿Cuántos g hay? 35

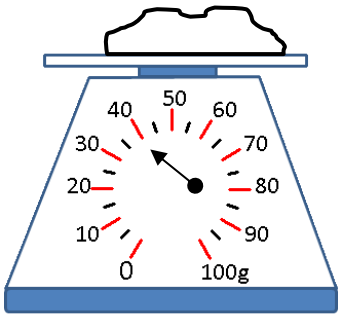

9) ¿Cuántos g hay? 95

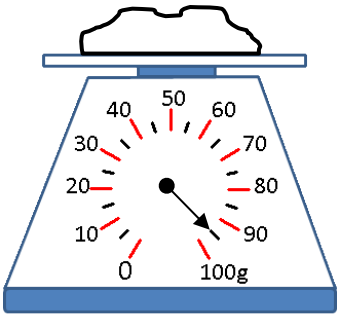

10) ¿Cuántos g hay? 65

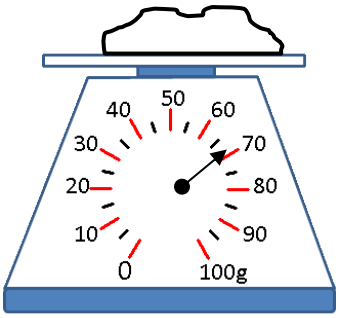

Copyright © MathCenter 2020